Finding Interval Qualities

(1, 4, 5, 8)

o - P - +

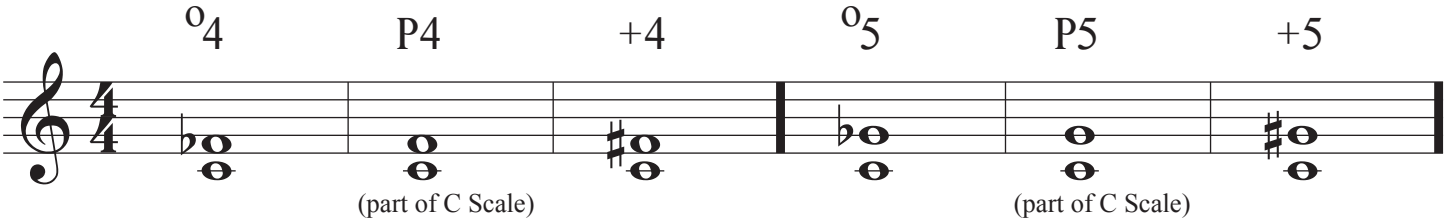

Identify these Intervals

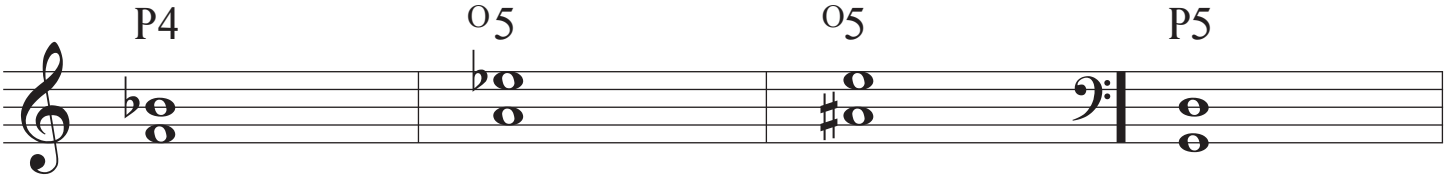

Write a note above the given note to match these Intervals



(2, 3, 6, 7)

o - m - M - +



Identify these Intervals



Write a note above the given note to match these Intervals